RIYOZIYOT

MOCK TESTLARI

2024 – 2025

- Prezident maktabi
- Al-Xorazmiy TIM
- Mirzo Ulug‘bek TIM
- Ixtisoslashtirilgan maktablar

Zafarbek Ibragimov

PIR
NASHR

Riyoziyot ITM

Ibragimov Zafarbek, Sayilova Muxabbat

Riyoziyot Mock testlari

2024 – 2025

“PIR”
Toshkent – 2026

UO‘K: 51(075.32)
KBK: 22.1ya72
I – 14

Ibragimov Zafarbek, Sayilova Muxabbat.
Riyoziyot Mock testlari (2024-2025) [Matn]: testlar to‘plami / Z. Ibragimov, M. Sayilova. – Toshkent: Ideal Polygraph, 2026. – 448 b.

KBK: 22.1ya72
UO‘K: 51(075.32)

Ushbu kitob Prezident maktablari va Ixtisoslashtirilgan maktablarga tayyorgarlik ko‘rayotgan o‘quvchilar uchun mo‘ljallangan. Savollar oxirgi yillardagi imtihon savollariga namuna sifatida tuzilgan bo‘lib, kitob 32 ta variantdan tashkil topgan. Variantlar 5 ta turdagi imtihonlar uchun ajratilgan bo‘lib, bular Prezident maktabi 1-bosqich imtihoni uchun 6 ta test, Ixtisoslashtirilgan maktablar uchun 6 ta test, Al-Xorazmiy TIM uchun 10 ta test, Mirzo Ulug‘bek TIM uchun 5 ta test va Prezident maktabi 2-bosqich imtihoni uchun 5 ta testdan iborat. Savollar matematika, mantiq, tanqidiy fikrlash va ingliz tili fanlaridan tuzilgan bo‘lib, ushbu testlarni ishlash davomida o‘quvchi arifmetik hisoblashni, mantiqiy va tanqidiy tahlil ko‘nikmalarini rivojlantirib boradi. Qolaversa, ingliz tilidagi testlarda grammatik yondashuv va matn bilan ishlash mahoratlarini ham oshirib borishadi. Ushbu kitob yuqorida nomi tilgan olingan maktablar imtihonida yaxshi natijani qo‘lga kiritmoqchi bo‘lgan har qanday o‘rganuvchi uchun eng yaxshi yordamchi bo‘la oladi.

@Riyoziyot_ITM

Video yechimlar uchun

Diqqat! Kitobni yoki uning bir qismini nusxalash, ko‘paytirish, shuningdek har qanday axborot tizimida nashriyot ruxsatisiz tarqatish taqiqlanadi. Mualliflik huquqini buzish jinoiy javobgarlikka sabab bo‘ladi.
Barcha huquqlar himoyalangan.

ISBN 978-9910-8474-5-5

© Ibragimov Zafarbek, Sayilova Muxabbat, 2026
© «PIR» nashriyoti, 2026

MUNDARIJA

Prezident maktabi 1-bosqich imtihoni uchun mock testlar

1-Mock test 6
2-Mock test 13
3-Mock test 20
4-Mock test 28
2023-2024-o‘quv yilidagi savollar 37
2024-2025-o‘quv yilidagi savollar 46

Ixtisoslashtirilgan maktab imtihoni uchun mock testlar

1-Mock test 55
2-Mock test 67
3-Mock test 78
4-Mock test 90
2023-2024-o‘quv yilidagi savollar 103
2024-2025-o‘quv yilidagi savollar 116

Al-Xorazmiy tayanch ixtisoslashtirilgan maktab imtihoni uchun mock testlar

1-Mock test 130
2-Mock test 142
3-Mock test 154
4-Mock test 166
5-Mock test 178
6-Mock test 191
7-Mock test 203
8-Mock test 215
2023-2024-o‘quv yilidagi savollar 228
2024-2025-o‘quv yilidagi savollar 242

Mirzo Ulug‘bek tayanch ixtisoslashtirilgan maktab imtihoni uchun mock testlar

1-Mock test 258
2-Mock test 269
3-Mock test 281
2023-2024-o‘quv yilidagi savollar 294
2024-2025-o‘quv yilidagi savollar 305

Prezident maktabi 2-bosqich imtihoni uchun mock testlar

1-Mock test 320
2-Mock test 342
3-Mock test 365
4-Mock test 391
2024-2025-o‘quv yilidagi savollar 417
Javoblar 440

1-Mock test

1. 28 065 134 soni uchun keltirilgan tasdiqlardan qaysi biri noto‘g‘ri:

A) 6 raqami joylashgan o‘rniga nisbatan 60 000 ga teng.
B) yuz minglar xonasida xona birligi mavjud emas.
C) minglar va birlar sinfidagi raqamlar yig‘indilarining farqi 1 ga teng.
D) 6-xonasidagi raqami va 6-raqami yig‘indisi 1 ga teng.

2. Quyidagi o‘nli kasrlar ichida eng katta va eng kichigi farqini toping:

a = 0.52 b = 0.3 c = 0.517 d = 0.24

A) 0.28
B) 0.277
C) 0.217
D) 0.22

3. 2 346 sonining raqamlari orasiga plus (+) belgisini qo‘yib qanday eng katta natijaga erishish mumkin?

A) 69
B) 240
C) 348
D) 322

4. $108 : 2 - 3 \cdot (\Delta + 11) = 12$ bo‘lsa, $(\Delta + 23) : 2$ ifodaning qiymatini toping.

A) 10
B) 13
C) 16
D) 9

5. 4 ta tarvuz og‘irligi 6 ta qovun og‘irligiga teng. 3 ta qovun og‘irligi 5 ta handalak og‘irligiga teng. 6 ta tarvuz og‘irligi nechta handalak og‘irligiga teng bo‘ladi?

A) 10 ta
B) 12 ta
C) 15 ta
D) 18 ta

NAMUNA

6. Qaysi shakl(lar)ning $\frac{1}{3}$ qismi bo‘yalmagan:

a) 

b) 

c) 

A) a
B) a va b
C) c
D) b va c

7. Hisoblang: 30 105 : 15 + 22 · 250 – 386

A) 7 121
B) 371
C) 5 321
D) 2 171

8. Quyidagi keltirilgan tasdiqlardan qaysi biri to‘g‘ri:

A) Aylanadagi eng kichik vatar bu radius.
B) Aylananing diametri radiusidan 2 marta kichik.
C) Uchburchak tomonlariga ko‘ra o‘tkir, o‘tmas va to‘g‘ri burchakli turlari mavjud.
D) barchasi noto‘g‘ri.

9. Elbek 160 betlik kitob o‘qishni boshladi. U payshanba kuni 10 bet va har keyingi kun oldingidan 10 bet ko‘proq kitob o‘qigan bo‘lsa, haftaning qaysi kunida Elbek kitobni butunlay o‘qib tugatgan bo‘ladi?

A) Dushanba
B) Seshanba
C) Chorshanba
D) Shanba

10. Yig‘indini hisoblang: 62 095 490 g + 14 q 8 kg 666 g

A) 62 244 156 g
B) 63 t 4 q 76 kg 156 g
C) 63 504 156 g
D) 7 t 7 q 4 kg 156 g

NAMUNA

14. Qutida qizil, qora, sariq, yashil va ko‘k rangli jami 48 ta shar bor. Ularning miqdori quyidagi diogrammada aks ettirilgan:

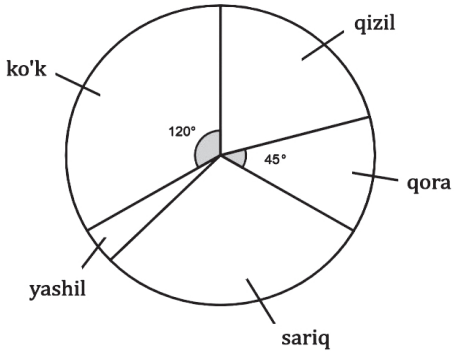

Ushbu qutida 2 ta yashil shar bo‘lsa, qizil va sariq sharlar qora va yashil sharlardan necha marta ko‘p?

A) 3
B) 4
C) 5
D) 2

15. Quyidagi shaklning qanday qismi bo‘yalgan:



A) $\frac{9}{43}$
B) $\frac{18}{59}$
C) $\frac{27}{86}$
D) $\frac{19}{59}$

NAMUNA

2024-2025-o‘quv yilidagi savollar

!!! Ushbu test savollari haqiqiy imtihonda tushgan savollar bo‘lib, ularni bevosita va bilvosita imtihonda qatnashgan o‘quvchi va ustozlar tilidan yozib olingan, hamda tahrirlangan.

1*. Bir milliondan sakkiz yuzga kam sonni toping.

A) 99 200
B) 98 200
C) 999 200
D) 998 200

2*. Ayni bir kunda 11:25 dan 14:15 gacha necha sekund bor?

A) 10 800
B) 9 600
C) 11 200
D) 10 200

3*. Hisoblang: CXXIV – XCVI

A) XXVIII
B) XXX
C) XVIII
D) XXIII

4*. Asila roppa-rosa 32 yoshda, Otabek esa undan 12 yosh kichik. Nodir Otabekdan 2 marta katta, Malikadan esa 10 yil yoshroq. Malika va Otabekning yoshlari yig‘indisini toping.

A) 90
B) 70
C) 60
D) 80

5*. Hisoblang: $1\frac{5}{8}-\frac{6}{8}$

A) $\frac{7}{8}$
B) $\frac{6}{8}$
C) $\frac{5}{8}$
D) $1\frac{1}{8}$

NAMUNA

26*. Quyidagi shakllardan nechtasi 2-darajali aylanish simmetriyasiga ega?

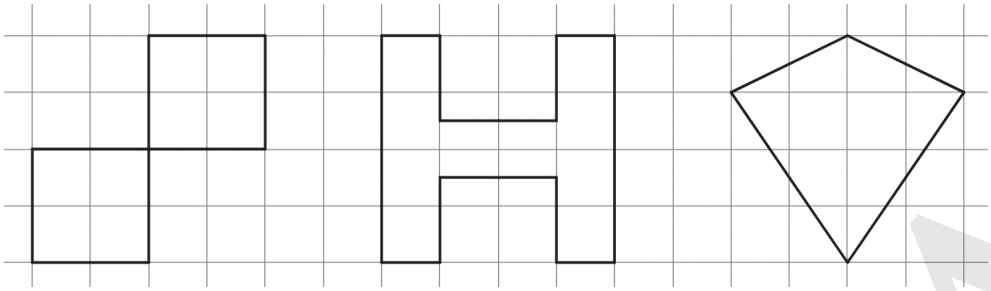

A) 1 ta
B) 2 ta
C) 3 ta
D) Hech biri

27*.

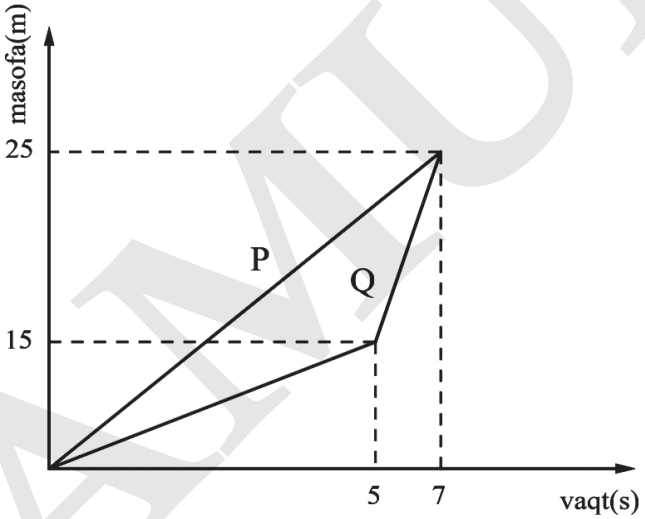

Berilgan grafik asosida P va Q yuguruvchilar haqidagi tasdiqlardan qaysi bir(lar)i to‘g‘ri:

a) P va Q yuguruvchilar dastlabki 7 sekundda bir xil masofa bosib o‘tgan.
b) Oxirgi 2 sekundda P yuguruvchi Q yuguruvchidan ko‘proq masofa bosib o‘tgan.
c) Q yuguruvchining dastlabki 5 sekunddagi tezligi, so‘nggi 2 sekunddagi tezligidan kam.

A) Faqat a
B) Faqat b
C) a va b
D) a va c

NAMUNA

12. Rasmda berilgan ma'lumotlardan foydalanib, A, B, C, D to'g'ri to'rtburchaklar perimetrlari yig'indisini toping:

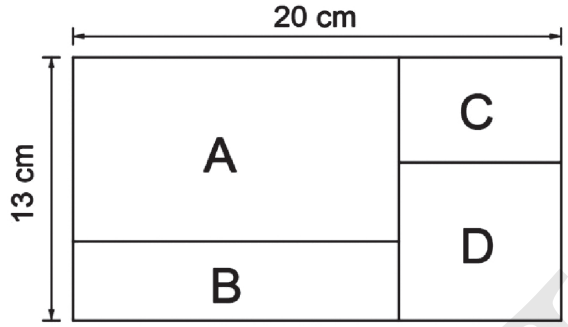

A) 66 cm
B) 99 cm
C) 132 cm
D) 165 cm

13. 66 ta o'quvchi aylana hosil qilib turishdi. Hisob boshi Anvar deb, soat strelkasi bo'ylab sanaganda Nodir 23-o'rinda turibdi. Agar Anvardan boshlab soat strelkasiga qarshi sanalsa, Nodir nechanchi o'rinda bo'ladi?

A) 43
B) 45
C) 44
D) 42

14. Berilgan chizmada 521 soni nechanchi qatorda joylashgan?
(1-qatorda 1, 2-qatorda 2 va 3 sonlari bor deb qaralsin)

1
2 3
4 5 6
7 8 9 10
. . . . . .

A) 29
B) 32
C) 33
D) 30

NAMUNA

29*. Nodir 1 dan 100 gacha 3 ga, 4 ga va 6 ga bo‘linadigan sonlarni Venn diagrammasiga joyladi. Ulardan 3 tasi, ya'ni A, B va C lar noma’lum bo‘lsa, A + B + C ifodaning qiymatini toping:

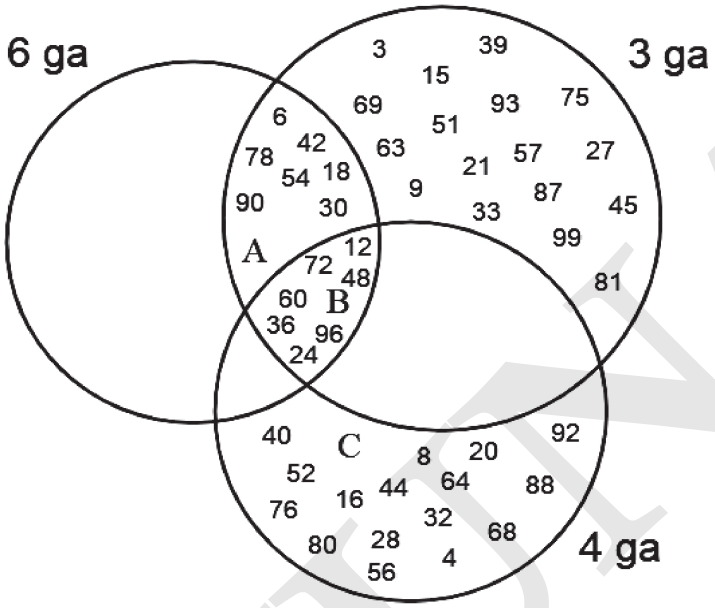

A) 239
B) 250
C) 206
D) 201

30*. A, B, C, D, E, F nuqtalar koordinatalarini o‘nlar xonasigacha yaxlitlang va ularning yig‘indisini topng:

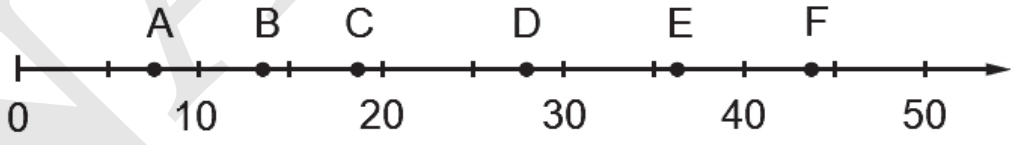

A) 130
B) 140
C) 150
D) 160

NAMUNA

31. You must _____ careful. It is dangerous.

A) to be
B) be
C) being
D) to being

32. We _____ to the beach on Sundays.

A) go
B) are going
C) went
D) are go

33. Do you have a car?

A) Yes, I have
B) Yes, I am
C) Yes, I do
D) Yes, I had

34. I _____ count three years ago, but now I _____ .

A) can / can
B) couldn't / can
C) couldn't / could
D) can't / can

35. _____ has won in the competition?

– Tom has.

A) What
B) Where
C) Whose
D) Who

36. There _____ many students last week.

A) was
B) are
C) were
D) is

NAMUNA

18. 12 yoshdan kichik bo‘lgan 4 nafar bolaning yoshlari ko‘paytmasi 5 544 ga teng bo‘lsa, ularning yoshlari yig‘indisini toping.

A) 36
B) 33
C) 35
D) 32

19. Quyidagi 1-rasmda 6 ta nuqta, 2-rasmda esa 24 ta nuqta bor. Shu ketma-ketlikda hosil qilingan 4-rasmda jami nechta nuqta bor:

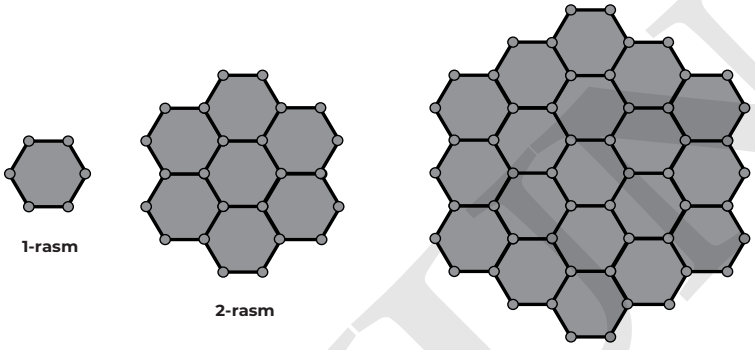

1-rasm 2-rasm 3-rasm

A) 240 ta
B) 144 ta
C) 96 ta
D) 72 ta

20. 20 dan kichik, hamda yig‘indisi 20 dan katta bo‘lgan nechta natural sonlar juftligi bor? ((10;11) va (11;10) bir xil juftlik deb qaralmasin)

A) 153 ta
B) 190 ta
C) 171 ta
D) 210 ta

21. 2 ta komputer, 3 ta planshet va 5 ta telefonning umumiy narxi 3 100 $.
3 ta komputer, 7 ta planshet va 10 ta telefonning umumiy narxi esa 4 900 $.
1 ta komputer, 3 ta planshet va 4 ta telefonning umumiy narxini toping?

A) 2 000 $
B) 1 700 $
C) 1 640 $
D) 1 400 $

NAMUNA

5-Mock test

1. Nechta 3 xonali sonning birlar va o‘nlar xonasidagi raqamlari farqi 4 ga teng?

A) 54 ta
B) 120 ta
C) 108 ta
D) 60 ta

2. A jismning yoqlari soni, B jismning qirralari soni va C jismning uchlari soni bir xil bo‘lsa, qaysi variant A, B, C jismlar uchun mos keladi?

A) A – yigirmaburchakli prizma, B – o‘nbirburchakli piramida, C – yigirmaburchakli piramida
B) A – o‘noltiburchakli piramida, B – sakkizburchakli prizma, C – o‘noltiburchakli piramida
C) A – o‘nburchakli prizma, B – kub, C – o‘nbirburchakli piramida
D) Hech biri

3. Quyida katta to‘g‘ri to‘rtburchak 16 ta bir xil to‘g‘ri to‘rtburchak va bo‘yalgan qismdan iborat. Bo‘yalgan soha katta to‘g‘ri to‘rtburchakning qanday qismini tashkil etadi?

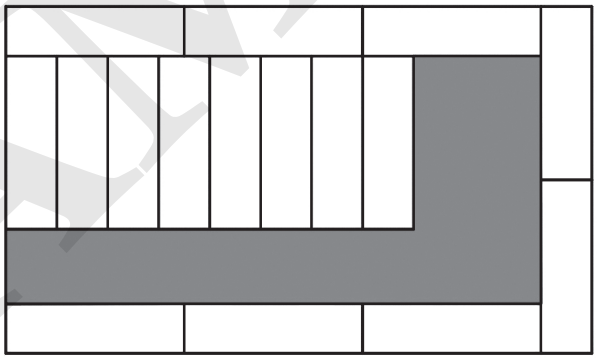

A) $\frac{7}{23}$
B) $\frac{5}{21}$
C) $\frac{6}{25}$
D) $\frac{11}{28}$

NAMUNA

11. Quyida A kvadrat yuzi 196 cm^2 bo‘lsa, B va C uchburchaklar yuzalari yig‘indisini toping?

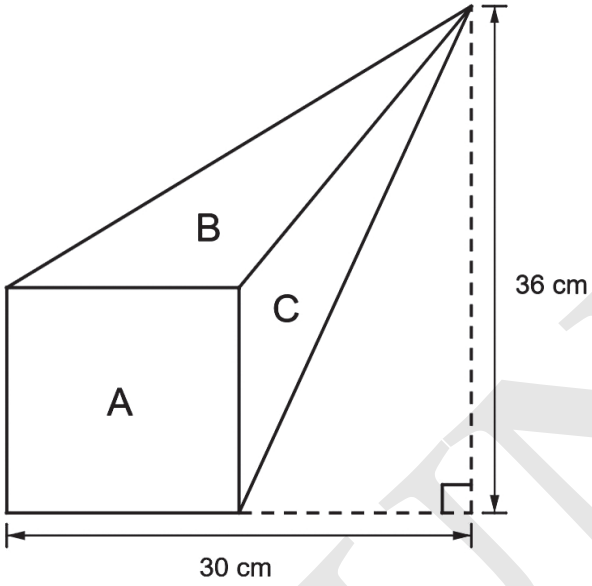

A) 266 cm^2
B) 284 cm^2
C) 240 cm^2
D) 302 cm^2

12. 6 ta pillapoyali zina bor. Anvar unga bir yoki ikki qadamlab 6-pillapoyaga chiqishi kerak. U bu ishni necha xil usulda amalga oshira oladi?

A) 4
B) 7
C) 13
D) 15

13. Son nurida olingan A, B, C va D nuqtalar koordinatalari yig‘indisi 100 ga teng. Bu nuqtalar ichida eng chapda joylashgan A nuqtadan B, C va D nuqtalargacha bo‘lgan masofalar yig‘indisi 36 ga teng bo‘lsa, A nuqta koordinatasining raqamlari yig‘indisini toping.

A) 5
B) 6
C) 7
D) 9

NAMUNA

2023-2024-o‘quv yilidagi savollar

!!! Ushbu test savollari haqiqiy imtihonda tushgan savollar bo‘lib, ularni bevosita va bilvosita imtihonda qatnashgan o‘quvchi va ustozlar tilidan yozib olingan, hamda tahrirlangan.

1*. Rasmda 3 ta kvadrat(yonma-yon) berilgan va ushbu kvadratlar PQRS to‘g‘ri to‘rtburchak ichiga joylashtirilgan:

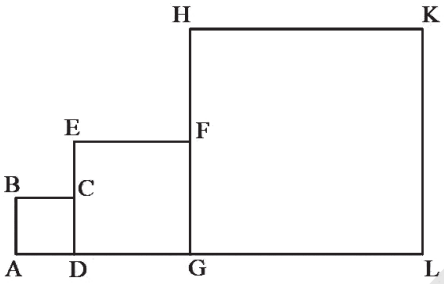

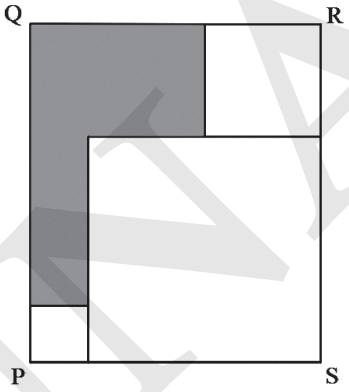

AB = CE, EF = FH va bo‘yalgan sohaning yuzi 36 cm^2 bo‘lsa, PQRS to‘g‘ri to‘rtburchak perimetrini toping.

A) 44 cm

B) 52 cm

C) 36 cm

D) 48 cm

2*. Yuzlar xonasigacha yaxlitlaganda 500 ga teng bo‘ladigan eng katta va eng kichik natural sonlar yig‘indisini toping.

A) 999

B) 1 049

C) 1 000

D) 951

3*. Kitob sahifalarini raqamlash uchun 826 ta raqam ishlatildi. Raqamlash 3-betdan 3 raqami bilan boshlanadi. Shunga ko‘ra, oxirgi varoqdan 1 ta oldingi varoqdagi sonlarning raqamlari yig‘indisini toping. (bu yerda 2 ta bir xil raqam 1 ta deb qaralmasin)

A) 6

B) 16

C) 11

D) 5

NAMUNA

6*. 78431982 > 78A31918 tengsizlik to‘g‘ri bo‘lishi uchun A o‘rniga qo‘yish mumkin bo‘lgan barcha raqamlarning yig‘indisini toping.

A) 10
B) 12
C) 16
D) 18

7*. Uchta har xil qalamning chizg‘ich ustidagi alohida ko‘rinishlari quyida berilgan (chizg‘ichdagi uzunliklar cm larda deb qaralsin).

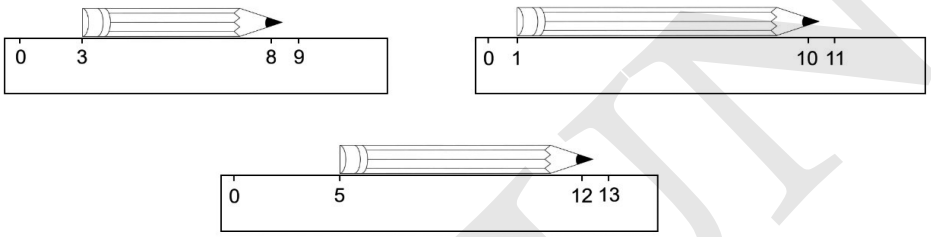

Bu uchta qalam bir-biri bilan rasmda ko‘rsatilganidek tutashtirilib, boshqa bir chizg‘ich ustida ko‘rsatilmoqda.

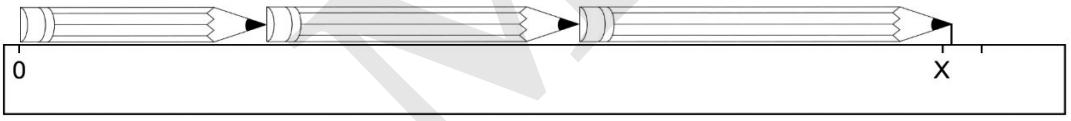

Agar x ning qiymati natural son bo‘lsa, u eng ko‘pi bilan necha cm ga teng bo‘ladi?

A) 21
B) 23
C) 24
D) 25

8*. Hisoblang: $3\frac{2}{7}+\frac{3}{7}+1\frac{1}{2}+4\frac{3}{7}+5\frac{1}{2}-2\frac{1}{7}$

A) 11
B) 12
C) 13
D) 14

NAMUNA

2-Mock test

1. 1 000 sonini 5 ta natural sonning ko‘paytmasi ko‘rinishida yozish mumkin bo‘lsa, ushbu 5 ta son yig‘indisini toping.

A) 37
B) 42
C) 50
D) 40

2. Tenglamani yeching: $3(-2x+8)-2(4-5x)=2-4(1-x)$

A) Cheksiz ko‘p yechimga ega
B) – 22
C) Yechimga ega emas
D) – 18

3. N – tub son. Agar N + 6, N + 8, N + 12, N + 14 ifodalar ham tub son ekanligi ma’lum bo‘lsa, N + 6 va N + 14 sonlarining ko‘paytmasini toping.

A) 513
B) 273
C) 713
D) 209

4. 6 ta natural bo‘luvchiga ega 2 xonali sonlar nechta?

A) 14 ta
B) 15 ta
C) 16 ta
D) 17 ta

5. Devoriy soat 16:00 ni ko‘rsatmoqda. Eng kamida qancha vaqtdan keyin minut va soat strelkalari orasidagi burchak 21° ni hosil qiladi?

A) 22 min
B) 11 min
C) 9 min
D) 18 min

NAMUNA

7*. ABCD – romb, FGHL – parallelogram va DEL – teng yonli uchburchak bo‘lsa, rasmda berilgan ma’lumotlardan foydalanib $x°$ burchakni toping:

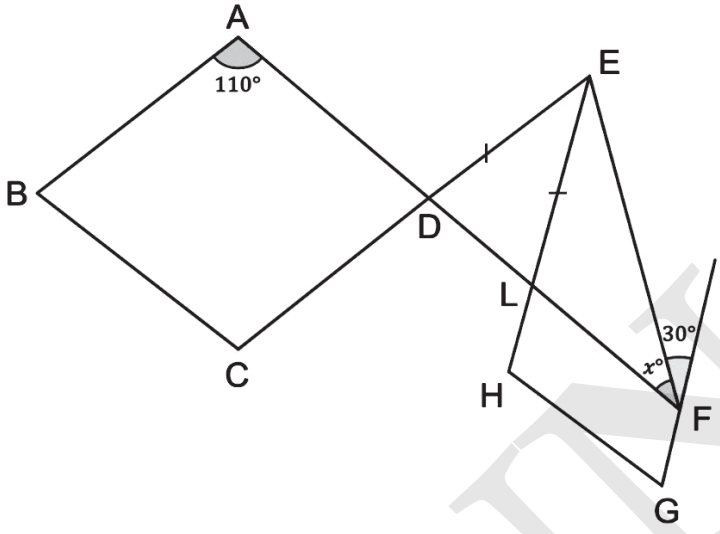

A) 40
B) 25
C) 80
D) 50

8*. Uchta yashikda jami 75 kg olma bor. Agar 1-yashikdan 2- va 3-yashiklarga mos ravishda $4\frac{1}{2}$ kg va $5\frac{1}{3}$ kg olma joylansa, har bir yashikda bir xil miqdorda olma hosil bo‘ladi.

Dastlab 1- va 3-yashikda jami necha kilogramm olma bo‘lgan?

A) 55
B) $57\frac{5}{6}$
C) 56
D) 54.5

9*. Ikkita avtosalondagi mashinalar soni 1 : 3 nisbatda edi. Ikkala avtosalonda ham 5 tadan mashina sotildi. Shundan so‘ng, ularda qolgan mashinalar soni 1 : 8 nisbatga teng bo‘ldi. Dastlab, ikkala salonda jami nechta mashina bo‘lgan?

A) 24
B) 30
C) 28
D) 32

NAMUNA

12. Fozilbekning elektron soatidagi bir nechta qismi ishlamay qoldi. U ertalab uyg‘onganida soat quyidagi ko‘rinishda edi:

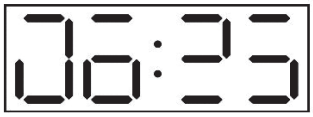

Ushbu soat 49 daqiqadan so‘ng qanday holatda ko‘rina olmaydi?

A) 

B) 

C) 

D) 

13. Jahongirning cho‘ntagida 3 xil 10 $, 5 $ va 1 $ lik tangalar bor. U cho‘ntagiga qaramasdan 3 ta tangani oldi. Jahongir olgan uchala tanganing umumiy miqdori turlicha bo‘lsa, barcha umumiy miqdorlar yig‘indisini toping.

A) 160 $
B) 150 $
C) 155 $
D) 165 $

14. “Yugurish musobaqasida har bir ishtirokchi kuchli o‘nlikka kirgani uchun kubok bilan yoki ishtirok etgani uchun medal bilan taqdirlanadi. Sarvar 14-o‘rinda marraga yetib keldi, demak u medal bilan taqdirlangan.”

Quyidagilardan qaysi birida yuqoridagi mulohazaga eng mos keluvchi fikr keltirilgan?

A) Maktab keyingi o‘quv yilida 100 nafardan ko‘p o‘quvchi qabul qilishi mumkin, agar ko‘proq sinf xonalar qurilsa. Maktab ma’muriyatiga qo‘shimcha sinf xonalar qurish uchun ruxsat berilmadi, demak ular o‘quvchilar sonini oshira olmaydi.

B) Do‘kon egasi dam olish kunlari ishlay oladigan ishchi qabul qilsa, ushbu do‘kon dam olish kunlari ham xizmat ko‘rsata oladi. Bugun yakshanba va do‘kon ochiq, demak u yangi ishchi yollagan.

C) Kamola va uning oilasi hayvonot bog‘iga borganda, agar havo ochiq bo‘lsa muzqaymoq yeyishadi, yomg‘ir yog‘sa kapalaklar uyini tomosha qilishadi. Kecha yomg‘ir yog‘madi, demak ular hayvonot bog‘ida muzqaymoq yegan.

D) Agar mushakbozlik noqonuniy sotilishda davom etsa, bayram kunlari kasalxonalarda yong‘in bilan bog‘liq bemorlar soni ko‘payadi. Bu yil bunday bemorlar soni kamaydi, demak noqonuniy mushakbozlikka qarshi kurash samarali kechmoqda.

NAMUNA

24. Quyida 3 ta futbol klubi "Chempionlar ligasi"da bir-birlari bilan 1 martadan o'ynagandan keyingi holat haqida ma'lumot berilgan:

Jamoa nomi	G'alabalar soni	Mag'lubiyatlar soni	Durranglar soni	Urilgan gollar soni	O'tkazib yuborilgan gollar soni
A	2	0	0	6	1
B	0	1	1	2	4
C	0	1	1	3	6

A va C jamoalar o'rtasidagi o'yin natijasi qanday bo'lganini toping.

A) 3:2
B) 4:1
C) 3:0
D) 2:1

25. Qafasda saqlanayotgan oq ayiqlar o'z harakatlarini tez-tez obsesif ravishda namoyon qiladi. Ular bir joydan oldinga yoki orqaga yuradi, boshini qafasga uradi va boshqa stress belgilarini ko'rsatadi. Bu holat hattoki qafaslari juda keng bo'lsa ham ko'p marotaba takrorlanadi. Bu shuni ko'rsatadiki, oq ayiqlar qafas sharoitida o'zlarini tabiiy muhitdagidek qoniqarli his qilmas ekanlar.

Quyidagilardan qaysi biri, agar rost bo'lsa, yuqoridagi xulosani eng ko'p zaiflashtiradi?

A) Oq ayiqlar asirlik sharoitiga moslashmagan.
B) Qafasda saqlanayotdan oq ayiqlar yovvoyi tabiatda omon qolish qobiliyatiga ega emas.
C) Ko'plab oq ayiqlar yovvoyi tabiatda ham o'zlarini obsesif xatti-xarakatlarini namoyon qilishadi.
D) Tabiiy muhitda yashovchi oq ayiqlar har kuni oziq-ovqat uchun katta masofalar bosib o'tishiga to'g'ri keladi.

26. Y shahrining aholisi faqat nafaqadagi odamlar bilan to'la va u yerda kichik yoshdagi bolali oilalar deyarli yo'q. Shunga qaramay Y shahrida chaqaloqlar va kichik yoshdagi bolalar uchun mebel ijaraga berishga ixtisoslashgan bizneslar juda ko'p.

Quyidagilardan qaysi biri, agar rost bo'lsa, yuqoridagi ziddiyatni eng yaxshi asoslay oladi?

A) Chaqaloqlar uchun mebel ijaraga berishga ixtisoslashgan bizneslar o'z mebelini Y shahridan tashqaridagi ishlab chiqaruvchidan sotib oladi.
B) Y shahrining ko'plab aholisida ko'chib yurish odati bor, shuning uchun ular mebellarni sotib olishdan ko'ra ijaraga olishni afzal ko'rishadi.
C) Y shahrida yashovchi deyarli barcha oila yiliga bir necha hafta mehmon bo'lib keladigan nabiralarining ehtiyojlarini qondirish uchun mebel ijaraga olishadi.
D) Ijaraga beriladigan mebellar sifati sotib olinadigan mebellar sifati bilan bir xil.

NAMUNA

28. 4 ta coffee barda qahva uchun chegirmalar berildi. Ulardan qaysi biri birlik massa uchun eng arzon?

A) 150 g qahvani 1.29 $ ga oling.
B) 200 g qahvani 2.89 $ ga oling va yana 200 g bepul beriladi.
C) 300 g qahvani 3.36 $ ga oling va keyingi 300 g uchun yarim narxida oling.
D) 150 g qahvani 2.22 $ ga oling va qo‘shimcha 50 g qahva bepul beriladi.

29.

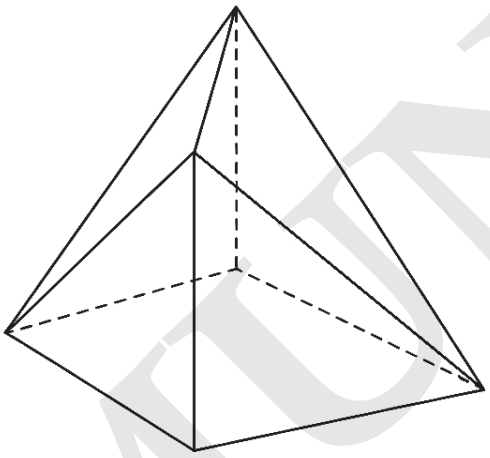

Quyidagilardan qaysi biri yuqoridagi jismning yoyilmasi bo‘la oladi?

A)
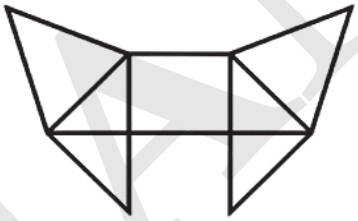

B)
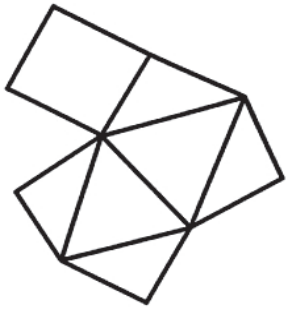

C)
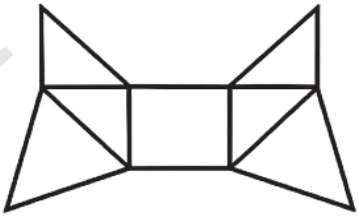

D)
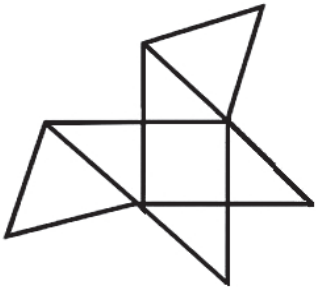

NAMUNA

Ingliz tili

For each questions(1-5), choose the correct answer.

1.

For Sale
Skateboard. Ideal for someone starting and for use on roads. Plus free skateboarding magazines.
Phone Chris
07789 44866

A) The skateboard is free.
B) The skateboard is perfect for a beginner.
C) Chris is also selling magazines.
D) The skateboard is very expensive.

2.

Hi Steve
The party at the club starts at 7.00. My mum is taking me and she can take you too. But I need to get there for 6.30. Can you be ready by then?
Kevin

A) Kevin needs to take his mum somewhere.
B) Kevin needs help getting ready.
C) Kevin wants to get to the party early.
D) Kevin's mum can't take Steve.

NAMUNA

3.

School Trip

Just a few tickets left.

See secretary to book your place by Friday.

A) The trip is on Friday.
B) You can only book on Friday.
C) Most of the tickets have now gone.
D) The trip is at the weekend.

4.

Hi Matt
I'm going on holiday this Saturday and I forgot to tell anyone at football. Could you tell the manager for me when you go.
Thanks
Sam

A) Sam wants Matt to speak to the manager.
B) Sam wants to play football on Saturday.
C) Sam needs to speak to the manager.
D) Sam wants to play with Matt.

5.

Cake Sale!

Friday only

Buy one get one free.

Sale ends 1.00pm

A) The sale is on all day Friday.
B) All cakes are free.
C) Cakes are not cheap
D) Get a free cake with one you buy.

NAMUNA

LIVING IN THE UK.

Madeleine came from Dakar to London twelve months ago. In the beginning, she missed everything – the weather, the food, her family. But now, she owns a profitable business with her two sisters and her brother. They run a pound shop in London's West End. Madeleine's boyfriend is now her husband, and they have three children who go to British schools. When asked why she came to England, Madeleine says immediately, 'Because I'd like to work hard and be successful.' She works very hard. She's at the shop all day and then she works as a nurse in the evening. 'That's why I love England,' she says.' You can be whatever you want to be. ''When I first came to England, I spoke basic English, and it was autumn. It was so cold and rainy! Now almost all my family are here, not only in London, but also in Scotland, and Wales. We meet about twice a year and have a huge Senegalese meal that takes about three hours! We're all happy here."

29. When did Madeleine come to England?

A) a year ago
B) a month ago
C) five years ago
D) two years ago

30. Madeleine runs a pound shop with _____ .

A) her family
B) her boyfriend
C) her husband
D) her collague

31. Where does Madeleine work in the evenings?

A) in a shop
B) in an office
C) in a hospital
D) at home

32. When Madeleine first came to England she_____ .

A) couldn't speak English at all
B) spoke a little English
C) spoke English very well
D) didn't know English

NAMUNA

Prezident maktabi 1-bosqich mock testlar javoblari

	1-Mock	2-Mock	3-Mock	4-Mock	2023-2024	2024-2025
1	C	C	C	D	B	C
2	A	C	C	A	B	D
3	C	D	D	B	D	A
4	B	C	B	B	B	B
5	C	A	B	D	C	A
6	D	D	D	C	D	B
7	A	A	B	B	D	B
8	D	B	D	B	C	A
9	B	B	C	D	A	C
10	C	D	D	A	A	C
11	A	A	B	A	D	D
12	C	D	B	C	B	C
13	D	B	A	A	A	D
14	A	A	D	A	C	A
15	A	B	A	C	B	C
16	C	C	A	C	C	D
17	A	B	A	B	B	A
18	D	D	D	D	C	B
19	C	B	B	A	B	C
20	B	B	C	C	C	B
21	D	A	A	D	A	D
22	D	B	D	B	B	C
23	C	A	C	A	A	C
24	A	C	B	C	C	C
25	D	D	C	C	C	A
26	A	C	A	C	C	B
27	C	B	C	D	A	D
28	C	D	A	B	B	B
29	D	C	A	D	B	B
30	C	A	C	A	B	A

NAMUNA